Geometry Name_____

Section 6.1 Assignment

Date_____ Period____

State the most specific name for each figure.

1) 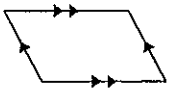

2) 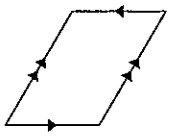

3) 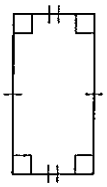

4) 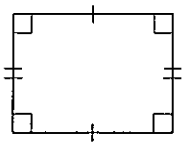

5) 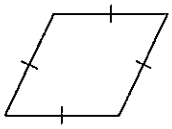

6) 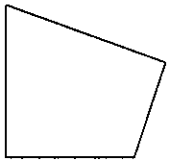

7) 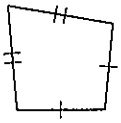

8) 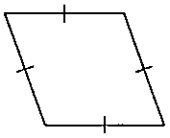

9) 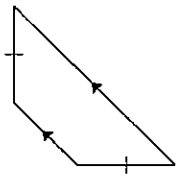

10) 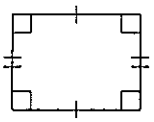

11) 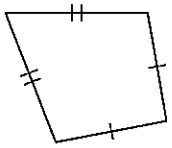

12) 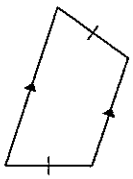

13)

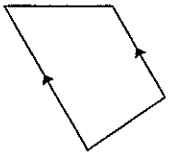

14)

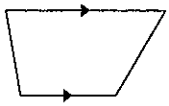

15)

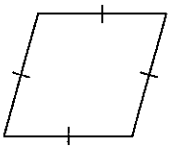

16)

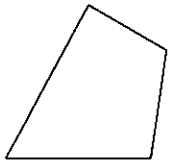

17)

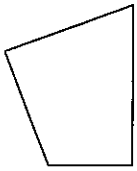

18)

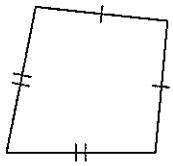

19)

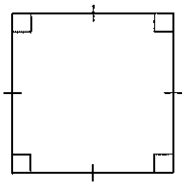

20)

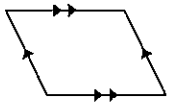

21)

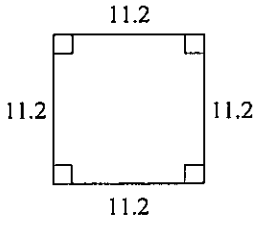

22)

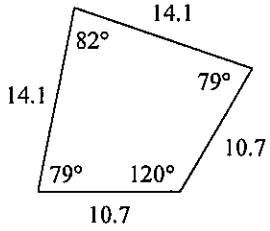

23)

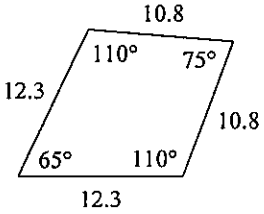

24)

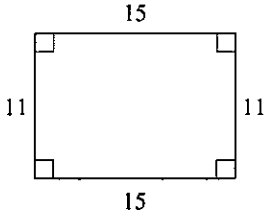

25)

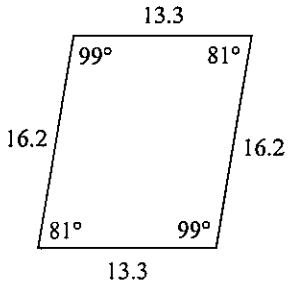

26)

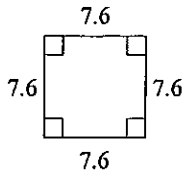

27)

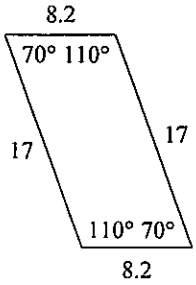

28)

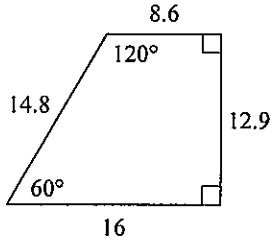

29)

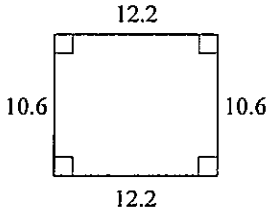

30)

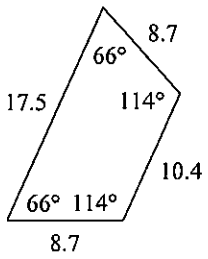

Find the measure of each angle indicated.

31)

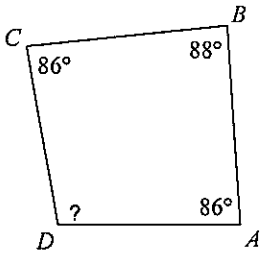

32)

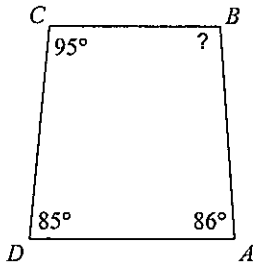

33)

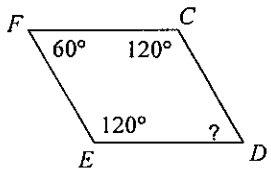

34)

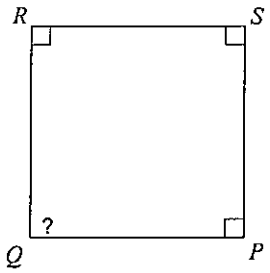

35)

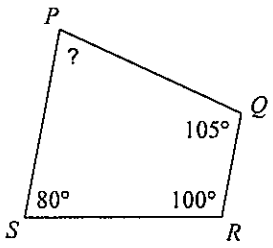

36)

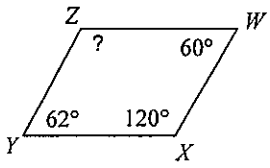

Determine whether each statement is true or false. Justify your answer.

37) All squares are rectangles.

38) A trapezoid is a parallelogram.

39) A rhombus can be a kite.

40) Some parallelograms are squares.

41) A rhombus can be a kite.

42) Every quadrilateral is a parallelogram.

43) All rhombuses are squares.